Kline Memorial School of UBS

Std – VI Mathematics Worksheet [III][2019-2020]

Date- 20/04/2020

Q1] Solve puzzles in your notebook.

1] In this puzzle you have to find the value of each shape and then find the answer.



2] Which number replaces the question mark?

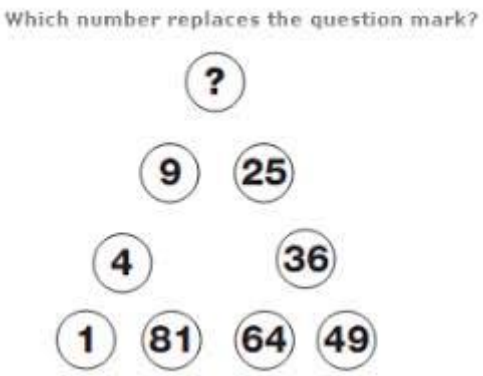

3] Can you solve this?

1 + 4 = 5

2 + 5 = 12

3 + 6 = 21

8 + 11 = ?

4] Solve this integer puzzle.

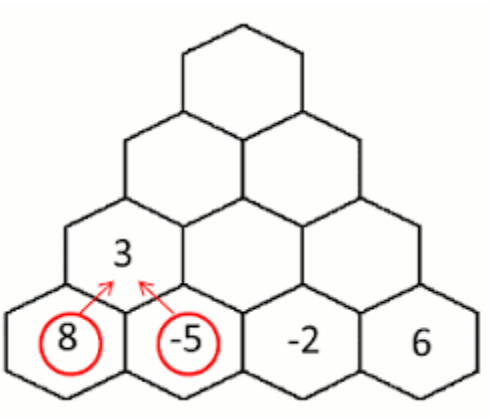

5] Find the value of each shape.

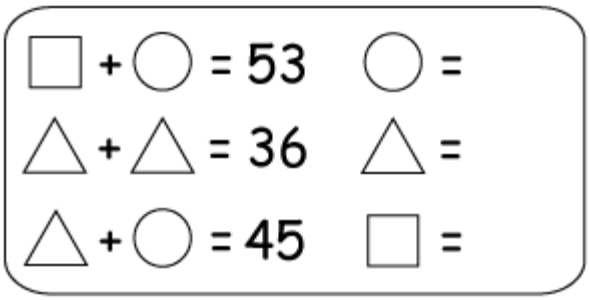

6] Find the missing number.

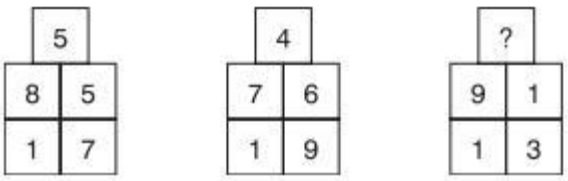

Q2] Write tables from 2 to 30 twice in your notebook.